Function Machines (Add & Subtract)

Name:

Determine the rule each function machine is using.

Ex)

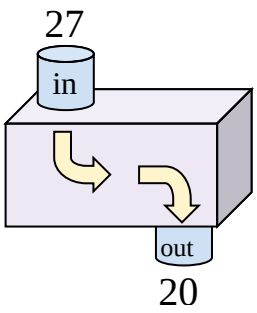

Subtract 7

1)

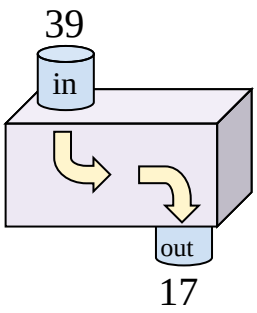

2)

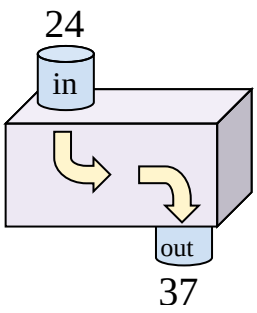

3)

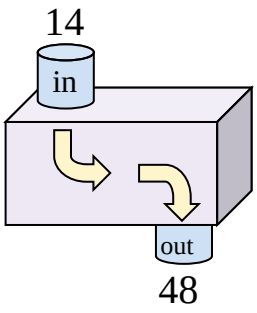

4)

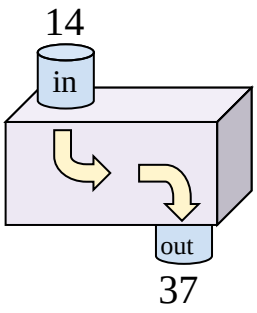

5)

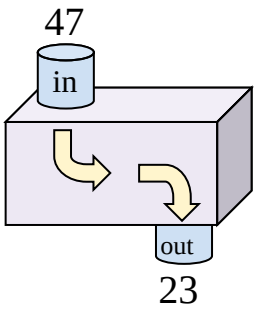

6)

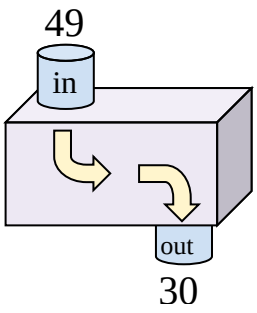

7)

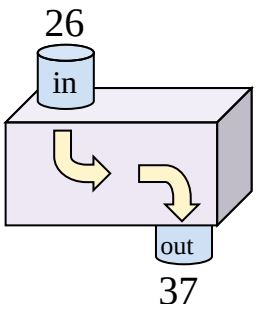

8)

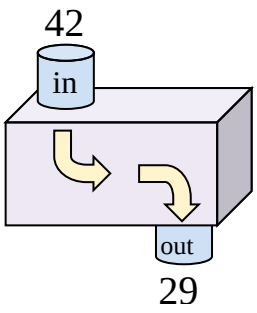

9)

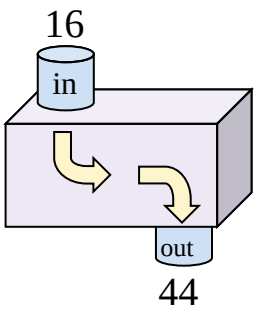

10)

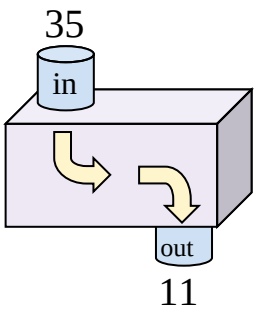

11)

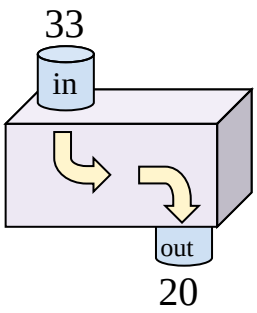

Answers

Ex. Subtract 7

1. _____
2. _____
3. _____
4. _____
5. _____
6. _____
7. _____
8. _____
9. _____
10. _____
11. _____

Name: **Answer Key**

Determine the rule each function machine is using.

Ex)

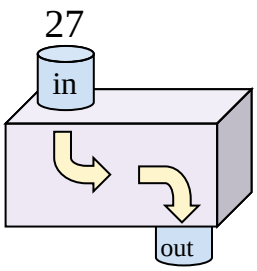

Subtract 7

1)

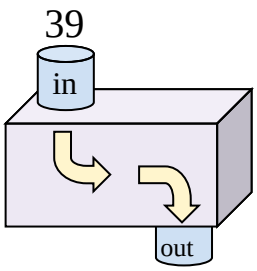

Subtract 22

2)

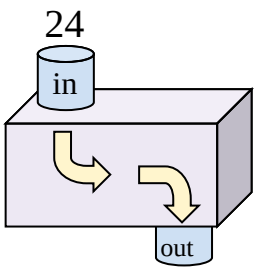

Add 13

3)

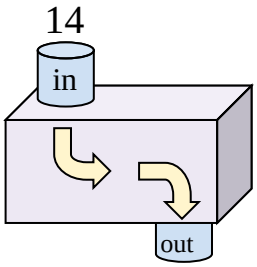

Add 34

4)

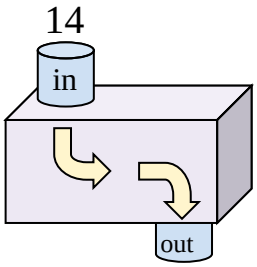

Add 23

5)

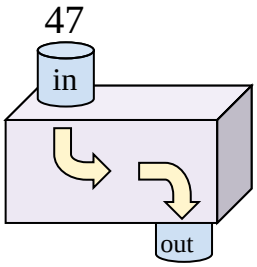

Subtract 24

6)

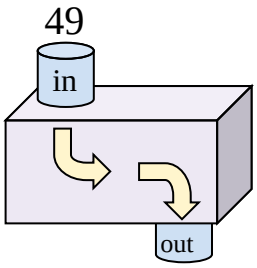

Subtract 19

7)

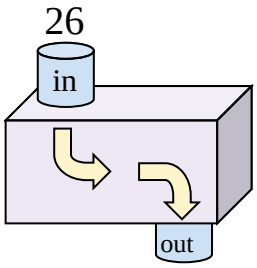

Add 11

8)

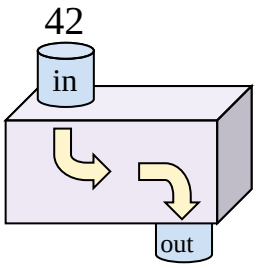

Subtract 13

9)

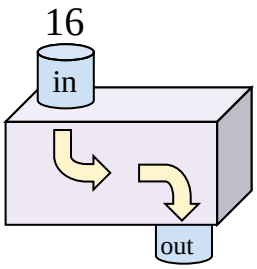

Add 28

10)

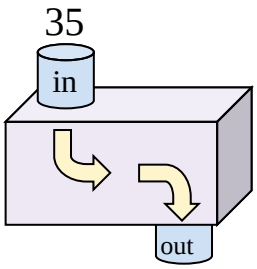

Subtract 24

11)

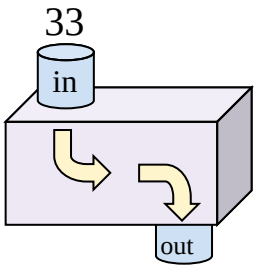

Subtract 13

Answers

Ex. Subtract 7

1. Subtract 22
2. Add 13
3. Add 34
4. Add 23
5. Subtract 24
6. Subtract 19
7. Add 11
8. Subtract 13
9. Add 28
10. Subtract 24
11. Subtract 13